NAME:_____ **Score: _____/ 69**

2 Minute Music Theory

Unit 3 TEST

Fill in the blanks with the correct answers.

1. Write the definition of bar line. _____

_____

2. Write the definition of measure. _____

_____

4/4 _____ how many beats in a measure

4/4 _____ what kind of note gets one beat

6/8 _____ how many beats in a measure

6/8 _____ what kind of note gets one beat

1. In the example below write the counts under each note.
2. Then place bar lines to mark the correct number of beats for each measure according to the time signature.

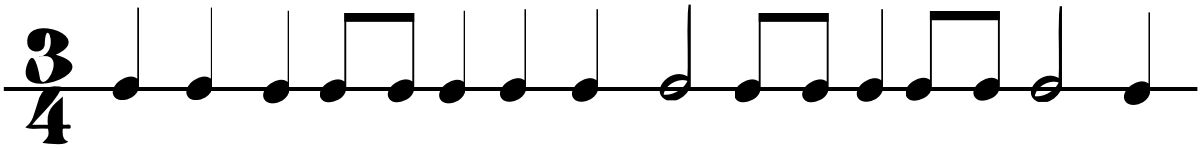

Count the rhythms below by writing the counts under the notes and rests.

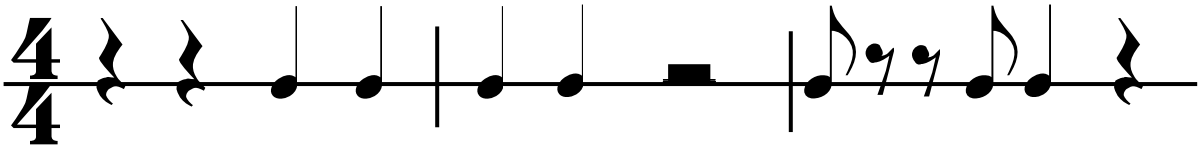

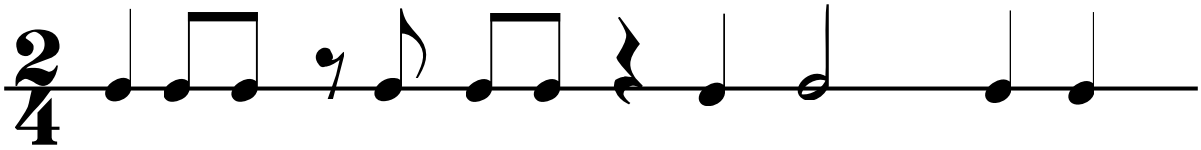
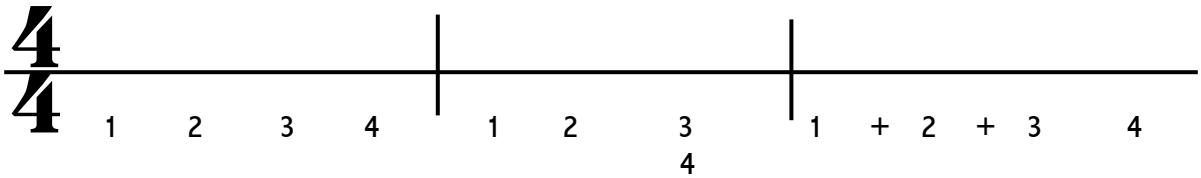
Write note or rests to match the counts in each measure below.